All rights reserved. No part of this publication may be reproduced, distributed, or transmitted in any form or by any means, electronic, mechanical, photocopying, recording or otherwise, or stored in any retrieval system of any nature without the permission of cracku.in, application for which shall be made to support@cracku.in

Downloaded from cracku.in

SSC CHSL 9th August 2021 Shift-3

English Language

1. **Select the most appropriate ANTONYM of the given word.**
   COMPLETE

A plentiful

B bulky

C partial

D vacant

Answer: C

2. **Select the most appropriate word to fill in the blank.**
   The prisoner was very upset and angry and there was _____ in her voice.

A bitterness

B thickness

C stillness

D eagerness

Answer: A

3. **In the given sentence, identify the segment which contains a grammatical error.**
   We've decided to spend our time play online games as we will not go out on a vacation this year.

A not go out

B play online games

C to spend our time

D we've decided

Answer: B

4. **Select the INCORRECTLY spelt word.**

A converse

B convert

C convean

D convent

Answer: C

SSC CHSL Free Mock Test

5. **Select the option which means the same as the group of words given.**
   One who cannot be reformed or changed

Downloaded from cracku.in

A invincible

B infallible

C incorrigible

D indelible

Answer: C

6. **Given below are four jumbled sentences. Out of the given options, select the one that gives their correct order.**
   A. It becomes evident from their stories that their desire to succeed became their driving force, their purpose in life.
   B. We read many stories of people who overcame serious disabilities.
   C. This is what made a paralytic, Wilma Rudolf, win three gold medals on the track in the 1960 Olympics.
   D. They wanted to prove to themselves that they could do it in spite of all odds - and they did it.

A BADC

B ACBD

C ADBC

D BCDA

Answer: A

7. **Select the word which means the same as the group of words given.**
   A person who pretends to have morals and beliefs that he or she doesn't believe in

A communal

B versatile

C hypocrite

D radical

Answer: C

SSC CHSL Prevoius Papers (DOWNLOAD PDF)

8. **Select the correct passive form of the given sentence.**
   We mow the lawn once every month.

A The lawn was mowed once every month.

B The lawn has been mowed once every month.

C The lawn is mowed once every month.

D The lawn will be mowed once every month.

Answer: C

9. **Given below are four jumbled sentences. Out of the given options, pick the one that gives their correct order.**
   A. They were covered with mud from head to foot.
   B. Two men were fighting, crying out and cursing, at the bottom of the ditch.
   C. "Stop that!" shouted the sergeant.
   D. Three or four soldiers, holding torches, were standing around a ditch.

Downloaded from cracku.in

A DCBA

B BDAC

C DBAC

D BACD

Answer: C

10. **Select the most appropriate option to substitute the underlined segment in the given sentence. If there is no need to substitute it, select 'No substitution'.**
Ashoka was one of the greater king of India.

A the more great kings

B the greater kings

C No substitution

D the greatest kings

Answer: D

SSC CGL Previous Papers (DOWNLOAD PDF)

11. **Select the most appropriate ANTONYM of the given word.**
NONDESCRIPT

A distinguished

B ordinary

C vague

D common

Answer: A

12. **Select the most appropriate meaning of the given idiom.**
A blessing in disguise

A something good that isn't recognised at first

B someone who comes disguised

C a person who blesses others quietly

D an event that is unknown

Answer: A

13. **Select the correct indirect form of the given sentence.**
The supervisor said to the staff, "Make sure that every room is disinfected properly."

A The supervisor instructed the staff to make sure that every room had been disinfected properly.

B The supervisor instructed the staff to make sure that every room was being disinfected properly.

Downloaded from cracku.in

C The supervisor instructs the staff to make sure that every room is disinfected properly.

D The supervisor instructed the staff to make sure that every room was disinfected properly.

Answer: D

SSC CGL Free Mock Test (Latest Pattern)

14. **Select the most appropriate meaning of the given idiom.**
Needle in a haystack

A Someone having vast opportunities

B Someone in trouble

C Something impossible to find

D Something very trivial

Answer: C

15. **Select the most appropriate synonym of the given word.**
COMPLICATED

A painful

B complex

C simplified

D plain

Answer: B

16. **In the given sentence, identify the segment which contains the grammatical error.**
Amphan, the more severe cyclone in the Bay of Bengal since the super cyclone of 1999, made landfall in the afternoon on Wednesday.

A since the super cyclone

B the more severe cyclone

C in the afternoon

D made landfall

Answer: B

SSC CHSL Important Questions and Answers (Download PDF)

17. **Select the INCORRECTLY spelt word.**

A collide

B conscious

C existence

D grammer

Downloaded from cracku.in

Answer: D

18. **Select the most appropriate option to substitute the underlined segment in the given sentence. If there is no need to substitute it, select 'No substitution'.**
Just like a spider that spins its own web and later destroys it, human beings can also destroy the web of desires that engulfs it.

A engulfs them

B engulfing it

C engulf it

D No substitution

Answer: A

19. **Select the most appropriate synonym of the given word.**
DELECTABLE

A luscious

B horrible

C unpleasant

D offensive

Answer: A

SSC CHSL Study Material

20. **Select the most appropriate option to fill in the blank.**
With a lot of difficulty, he could _____ only two tickets for the train from Mumbai to Ranchi.

A procure

B gain

C incur

D attain

Answer: A

Instructions [21 - 25]

In the following passage some words have been deleted. Fill in the blanks with the help of the alternatives given. Select the most appropriate option for each blank.

Comprehension:
Students in the sixth grade of a certain school in Navi Mumbai love (1)_____ History lessons, thanks to a novel teaching aid. It (2) _____ not surprising given the fact that their study material (3) _____ comic books and they use their textbooks for (4) _____ to put things into perspective. Besides, students are (5) _____ to tap other sources of information as well.

21. **Select the most appropriate option for blank no. 1.**

A her

B their

C them

Downloaded from cracku.in

D our

Answer: B

22. **Select the most appropriate option for blank no. 2.**

A were

B was

C are

D is

Answer: D

SSC CHSL Free App

23. **Select the most appropriate option for blank no. 3.**

A is including

B includes

C include

D has included

Answer: B

24. **Select the most appropriate option for blank no. 4.**

A suggestion

B reference

C practice

D indication

Answer: B

25. **Select the most appropriate option for blank no. 5.**

A boosted

B encouraged

C heartened

D cheered

Answer: B

Daily Free SSC Practice Set

General Intelligence

Downloaded from cracku.in

26. **Select the word-pair in which the two words are related in the same way as are the two words in the following word-pair.**
Bread : Wheat

A Sauce : Tomato

B Meal : Flour

C Book : Library

D Zoo : Animal

Answer: A

Free SSC Study Material (18,000 Solved Questions)

27. **Read the given statements and conclusions carefully. Assuming that the information given in the statements is true, even if it appears to be at variance with commonly known facts, decide which of the given conclusions logically follow(s) from the statements.**
Statements:
Some magicians are psychologists.
All psychologists are tourists.
Conclusions:
I. All tourists are psychologists.
II. All magicians are tourists.

A Both conclusions I and II follow

B Only conclusion I follows

C Only conclusion II follows

D Neither conclusion I nor II follows

Answer: D

28. **Indicating to a female, Raj told, 'She my mother's grandfather's brother's only daughter'. How female is related to Raj?**

A Sister in law

B Paternal Aunt

C Cousin Sister

D Sister

Answer: B

29. **Select the figure that will come next in the following figure series.**



Downloaded from cracku.in

A 

B 

C

D

Answer: B

1500+ Very Important Free SSC Solved Questions

30. **Arrange the following words in a meaningful sequence.**
    1. Plan
    2. Shop
    3. Mall
    4. Drive
    5. Return

A 1, 4, 3, 2, 5

B 3, 4, 5, 2, 1

C 1, 4, 2, 5, 3

D 4, 5, 1, 2, 3

Answer: A

31. **Select the option that is related to the third term in the same way as the second term is related to the first term.**
    RIGHT : UGKKR : : CHAOS : ?

Downloaded from cracku.in

A FQREF

B FEFRQ

C FREFQ

D FFERQ

Answer: D

32. **The sequence of folding a piece of paper and the manner in which the folded paper has been cutis shown in the following figures. How would this paper look when unfolded?**

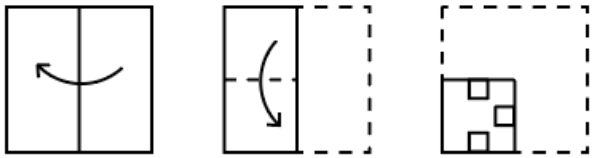

A 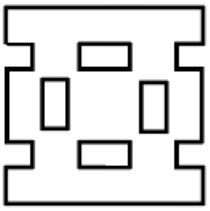

B 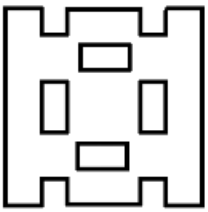

C 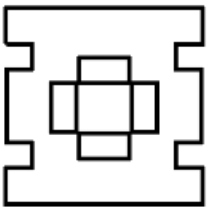

D 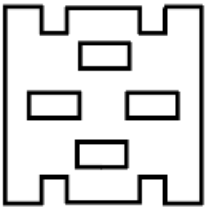

Answer: B

SSC Exam Update Videos & Free Study Material (YouTube Channel)

33. **Select the correct mirror image of the given combination when the mirror is placed at 'PQ' as shown.**

A

Downloaded from cracku.in

B

C

D 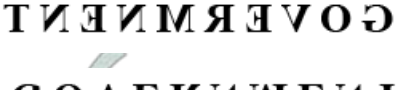

Answer: A

34. **Select the correct combination of mathematical signs that can sequentially replace the * signs and balance the given equation.**
7 * 96 * 8 * 39 * 25 = 70

A $\times, -, \div, +$

B $\times, \div, -, +$

C $+, \div, -, \times$

D $-, \times, \div, +$

Answer: B

35. **Five of the following six numbers are alike in a certain way and one is different. Select the number that is different from the rest.**
8, 24, 125, 343, 1331, 2197

A 2197

B 1331

C 24

D 125

Answer: C

Latest Job Updates on Telegram - Join here

36. **Two different positions of the same dice are given below. How many dots will be on the face opposite to the face having 1 dot?**

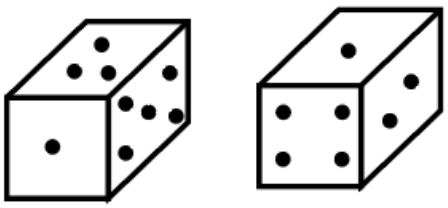

A 6

B 2

C 5

D 4

Answer: A

Downloaded from cracku.in

37. **Find the number of circles in the following figure.**



A 6

B 8

C 10

D 11

Answer: A

38. **Select the option in which the given figure is embedded (rotation is NOT allowed).**

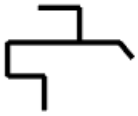

A

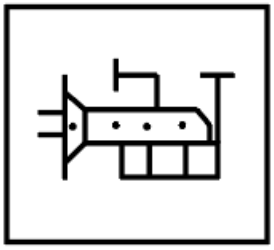

B

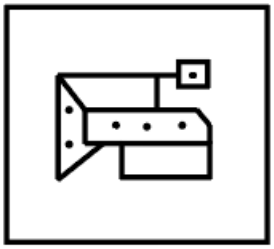

C

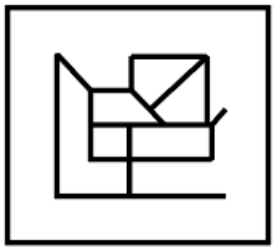

Downloaded from cracku.in

D 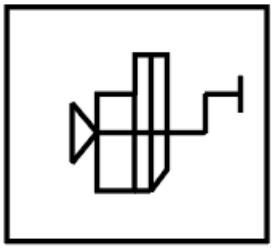

Answer: A

Join SSC Daily Quiz Telegram Group

39. **Select the option in which the numbers are related in the same way as are the numbers of the following set.**
(3, 3, 11)

A (4, 5, 18)

B (5, 8, 26)

C (7, 11, 35)

D (6, 15, 47)

Answer: C

40. **Three of the following four number triads are alike in a certain way and one is different. Select the one that is different.**

A (3, 6, 9)

B (2, 4, 8)

C (1, 2, 1)

D (4, 8, 16)

Answer: B

41. **Select the option that is related to the third word in the same way as the second word is related to the first word.**
Dolphins : Click : : Jackals : ?

A Bleat

B Scream

C Squeak

D Howl

Answer: D

Downloaded from cracku.in

42. **Observe the following diagram and answer the question that follows.**

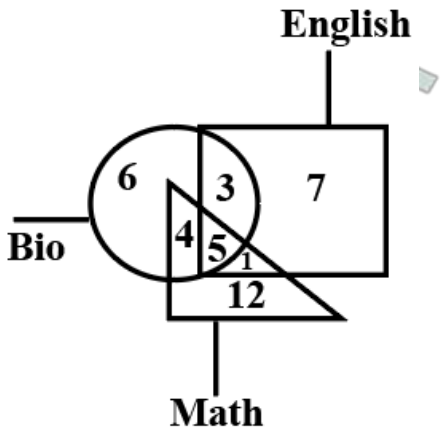

Find the number of students who study two or more subjects.

A 9

B 13

C 7

D 5

Answer: B

43. **In a certain code language, VIRTUE is written as XCBYAN. How will MODEST be written in that language?**

A IJNYYS

B JISYNY

C INYJYS

D JISNYY

Answer: D

44. **If in a code language, DISK is coded as 65 and WIRE is coded as 53, then how will you code CELL?**

A 46

B 32

C 76

D 82

Answer: C

SSC CHSL Free Mock Test

45. **Select the option that is related to the third number in the same way as the second number is related to the first number.**
27 : 702 : : 12 : ?

A 402

B 103

Downloaded from cracku.in

C 341

D 132

Answer: D

46. **Select the number from among the given options that can replace the question mark (?) in the following series.**
5, 9, 16, 31, 60, 119, ?

A 436

B 326

C 236

D 346

Answer: C

47. **Select the combination of letters that when sequentially placed in the blanks of the given series will complete the series.**
k l _ p n _ k l m p _ b _ l m _ n b k _ m p n b

A m, n, b, p, k, l

B k, l, m, n, b, p

C m, b, n, k, p, l

D n, m, b, l, p, k

Answer: C

SSC CHSL Prevoius Papers (DOWNLOAD PDF)

48. **Rohit is three times the age of his son Rishabh. Five years ago, he was four times older than Rishabh. What is Rohit's age at present?**

A 45 years

B 60 years

C 30 years

D 15 years

Answer: A

49. **Three of the following four letter-clusters are alike in a certain way and one is different. Select the odd one.**

A ULO

B ILO

C ENO

D UOD

Answer: D

50. **Four words have been given, out of which three are alike in some manner and one is different. Select the word that is different.**

Downloaded from cracku.in

A Horde

B Piglet

C Ambush

D Herd

Answer: B

SSC CGL Previous Papers (DOWNLOAD PDF)

Quantitative Aptitude

51. **For what value of θ (in degrees) is the following equation true?**
$\sin 3\theta \cos\theta - \cos 3\theta \sin\theta = \frac{1}{2}, 0 < \theta < \frac{\pi}{2}$

A 45

B 30

C 60

D 15

Answer: D

SSC CGL Free Mock Test (Latest Pattern)

52. **If $a^2 + b^2 + c^2 = 576$ and $(ab + bc + ca) = 50$, then what is the value of (a + b + c), if(a + b + c) < 0 ?**

A ± 26

B -24

C -26

D ± 24

Answer: C

53. **A bought a thing in ₹900 and sold to B at 25% profit. B sold it to C on ₹1350 at a loss of 10%. What is the approx. profit percentage of B?**

A 33

B 30

C 35

D 34

Answer: A

54. **The list price of coconut oil is 15% more than its cost price. At what per cent less should it be sold for no profit and no loss?**

A $13\frac{3}{23}\%$

Downloaded from cracku.in

B $13\frac{11}{23}\%$

C $13\frac{2}{23}\%$

D $13\frac{4}{23}\%$

Answer: B

SSC CHSL Important Questions and Answers (Download PDF)

55. **Study the given bar graphs and answer the question that follows.**
The bar graphs represent the amount invested in raw materials (in 2 crore) and the sale of the products, by a textile companyin the years 2007— 2012. The X-axis represents the years. The Y-axis represents the amount invested in raw materials (in 2 crore) in figure 1 and sale of products in figure 2, respectively.

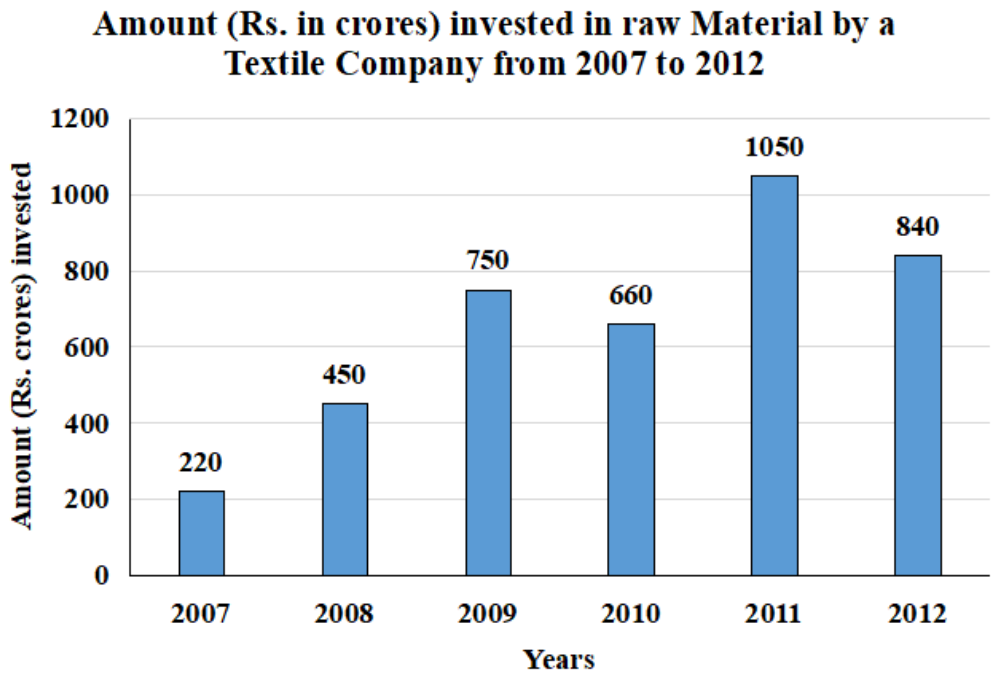

Figure 1

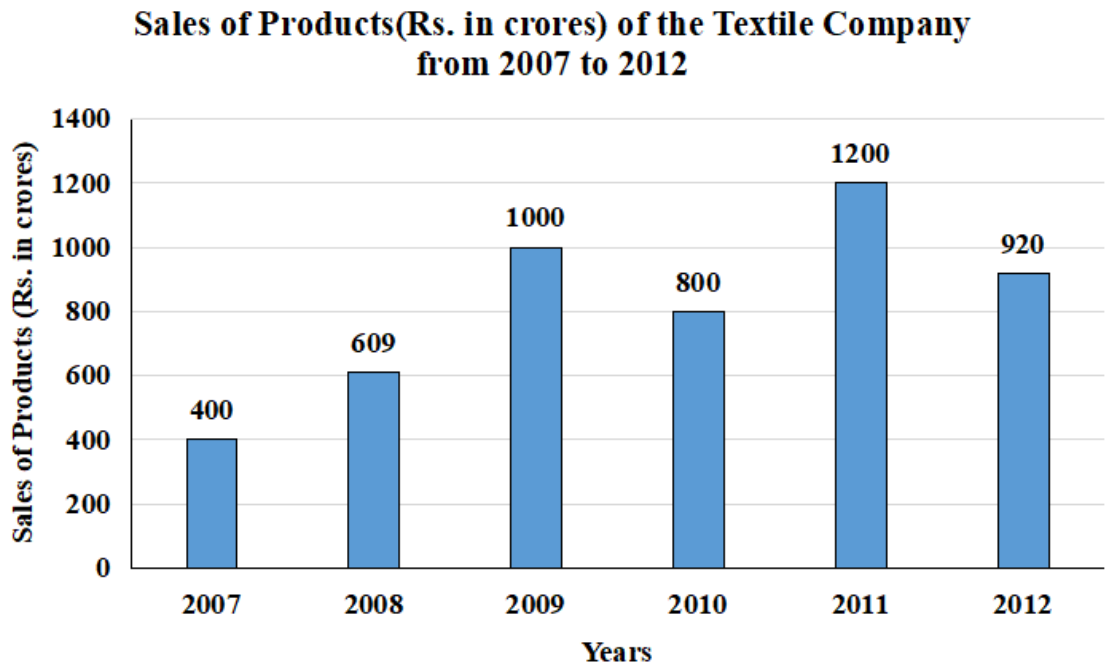

Figure 2

In which two years was the difference of the amount invested and the sales of products the same?

Downloaded from cracku.in

A 2009 and 2012

B 2010 and 2011

C 2007 and 2009

D 2008 and 2011

Answer: D

56. **The value of**
$28 \div [25 + 8 \div 4 - \{25 + (25 of 8 \div 20) - (125 \div 5 of 25)\}] + (25 \times 5)$ **is:**

A 129

B -121

C -4

D 121

Answer: D

57. **If** $\left(2x + \frac{1}{2x}\right) = 5$**, then what is the value of** $\left(8x^3 + \frac{1}{8x^3}\right)$

A 110

B 120

C 100

D 125

Answer: A

SSC CHSL Study Material

58. **Study the given graph and answer the question that follows.**

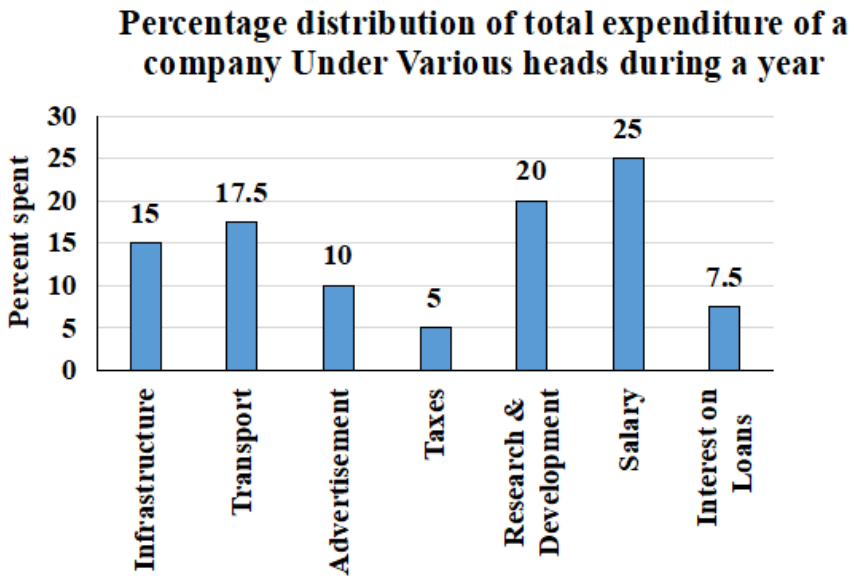

What is the ratio of the total expenditure on Infrastructure and Transport to the total expenditure on Taxes and Interest on Loans?

Downloaded from cracku.in

A 13 : 5

B 13 : 6

C 13 : 7

D 13 : 8

Answer: A

59. **A can complete one-sixth of a work in 5 days and B can complete one-fourth of the same work in 15 days. In how many days, will both working together complete the work?**

A 20 days

B 10 days

C 25 days

D 12 days

Answer: A

60. **Chords AB and CD of a circle intersect externally at P. If AB = 8.8 cm, PB = 7.2 cm, PD = 6.4 cm, then CD is equal to:**

A 10.8 cm

B 10.6 cm

C 11.4 cm

D 11.6 cm

Answer: D

SSC CHSL Free App

61. **The total surface area of a solid cube is 4.86 m ^{2}. It is melted and recastinto a right circular cylinderof radius 0.3 m. What is the height (in m)of the cylinder (correct to one decimal place)? Take $\pi = \frac{22}{7}$**

A 1.8

B 2.6

C 2.8

D 3.5

Answer: B

62. **In what time will a sum of ₹1,25,000 amountto ₹1,48,877 at 12% per annum, if interest is being compounded half yearly?**

A $1\frac{1}{2}$ year

B $2\frac{1}{2}$ years

C 1 year

Downloaded from cracku.in

D 3 years

Answer: A

63. **If $\sin B = \frac{9}{11}$, then what is the value of $\cot B$, where $0^\circ < B < 90^\circ$?**

A $\frac{41}{9}$

B $\frac{40}{9}$

C $\frac{9}{41}$

D $\frac{9}{40}$

Answer: B

Daily Free SSC Practice Set

64. **Two trains X and Yof lengths 450 meters and 550 meters, respectively, are running in the same direction on parallel tracks. If the speeds of X and Yare 58 km/h and 86 knvh, respectively, then what will be the time taken by them to cross each other? (correct to one decimal place)**

A 122.6 seconds

B 128.6 seconds

C 126.6 seconds

D 124.6 seconds

Answer: B

65. **The value of $\frac{\cos 8^\circ \cos 24^\circ \cos 60^\circ \cos 66^\circ \cos 82^\circ}{\sin 82^\circ \sin 66^\circ \sin 60^\circ \sin 8^\circ \sin 24^\circ}$ is:**

A 1

B $\frac{1}{\sqrt{2}}$

C $\frac{1}{\sqrt{3}}$

D 0

Answer: C

Downloaded from cracku.in

66. Study the following graph and answer the question that follows.
Number of students that appeared and qualified, from various colleges, at a scholarship examination.

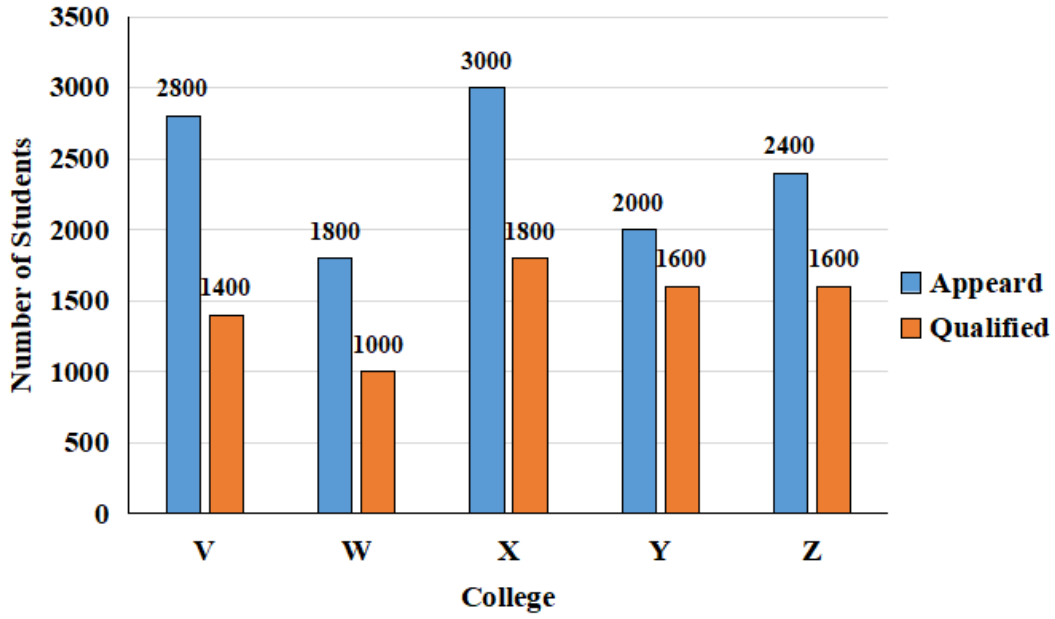

The average number of students that qualified in the examination from Colleges X and Y is what percentage of the average number of students that appeared for the examination from the same colleges?

A 66

B 68

C 62

D 64

Answer: B

Free SSC Study Material (18,000 Solved Questions)

67. If $3x + y = 12$ and $xy = 9$, then the value of $(3x - y)$ is:

A 4

B 5

C 6

D 3

Answer: C

68. The difference between the two perpendicular sides of a right-angled triangle is 17 cm andits area is 84 cm ^{2} , What is the perimeter (in cm) of the triangle?

A 56

B 65

C 72

D 49

Downloaded from cracku.in

Answer: A

69. **The perimeter of an isosceles triangle is 220 cm.If the base is 40 cm, then the length of each ofthe other sides is:**

A 85 cm

B 90 cm

C 80 cm

D 95 cm

Answer: B

1500+ Very Important Free SSC Solved Questions

70. **If $x : y = 4 : 5$, then the value of $(8x - 6y) : (9x - 7y)$ is:**

A 2 : 1

B 1 : 2

C 2 : 3

D 1 : 3

Answer: A

71. **If $34^{47} + 43^{47}$ is divided by 37, the remainder is:**

A 2

B 3

C 0

D 1

Answer: C

72. **A dealer allows his customers a discount of 35% and still gains 30%. If the cost price of an article is ₹950, then what is its marked price (in ₹)?**

A 1,900

B 1,750

C 1,800

D 1,500

Answer: A

SSC Exam Update Videos & Free Study Material (YouTube Channel)

73. **Ina circle, two chords UV and WX intersect each other at a point Z within the circle. If UV = 18 cm, ZV = 6 cm and WZ = 9 cm, then the length of ZY is:**

Downloaded from cracku.in

A 6 cm

B 8 cm

C 4 cm

D 10 cm

Answer: B

74. **Study the given bar graph and answer the question that follows.**
A soft drink company prepares drinks of three different flavors A, B and C. The bar graph shows the production of three flavors over a period of five years from 2010 to 2014.

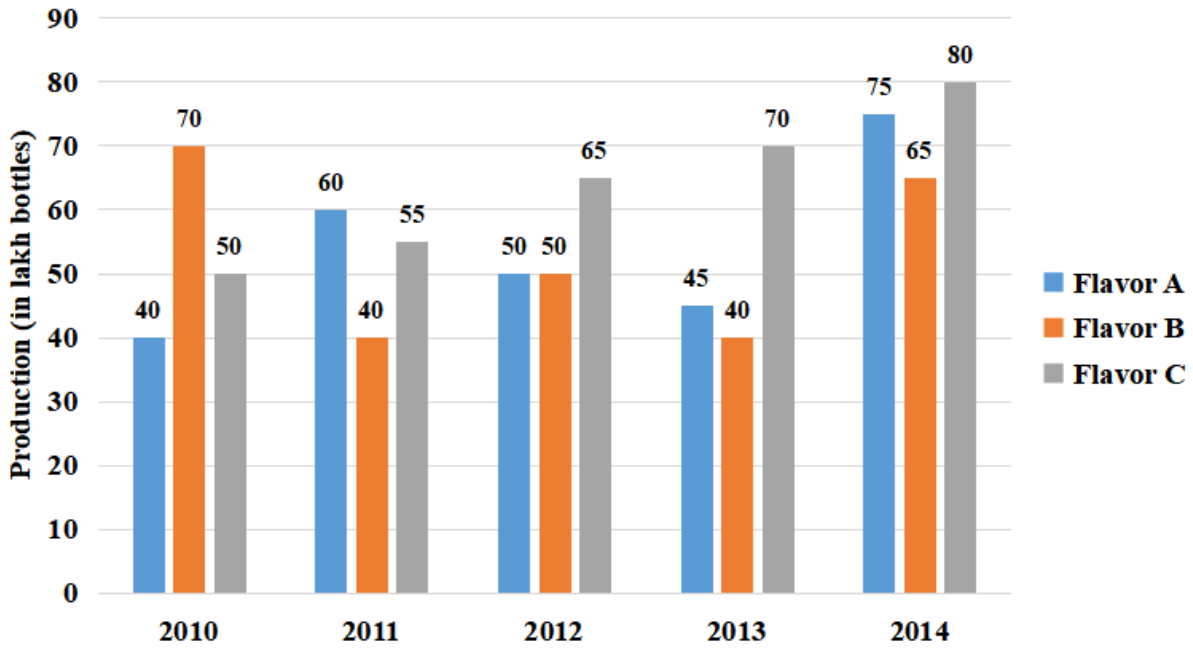

What percentage of the total production of soft drink of flavor A in 2013 and 2014 is the total production of soft drink of flavor B in 2011 and 2012?

A 60%

B 70%

C 55%

D 75%

Answer: D

75. **The average of 29 numbers is 38. The average of the first 19 numbers is 34 andthat of the last 9 numbers is 48. The 20 number is:**

A 28

B 26

C 24

D 22

Answer: C

Downloaded from cracku.in

Latest Job Updates on Telegram - Join here

General Awareness

76. **Who among the following is the author of 'The Brahma Sutra - The Philosophy of Spiritual life'?**

A Sarvepalli Radhakrishnan

B Indira Gandhi

C Sarojini Naidu

D Rajendra Prasad

Answer: A

Join SSC Daily Quiz Telegram Group

77. **Which company invested ₹11,400 crores during the financial year 2019-2020 across its market payments and wholesale business units in India to strengthen its foothold in India?**

A Apple Inc.

B Walmart Inc.

C eBay Inc.

D Amazon.com, Inc.

Answer: D

78. **Who became the Chief Justice of Jammu and Kashmir High Court in December 2020?**

A Sanjib Banerjee

B Pankaj Mithal

C Hemant Kumar Pandey

D Umesh Sinha

Answer: B

79. **A mass of snow and ice that moves slowly under the influence of gravity along a confined course away from its place of accumulation is called a _____.**

A lagoon

B glacier

C block mountain

D plateau

Answer: B

80. **Who among the following is one of the seven winners of the Young Champions of the Earth 2020 prize given by UNEP?**

Downloaded from cracku.in

A Veer Vikram Singh

B Vidyut Mohan

C Suchi Chaudhary

D Khushi Chindaliya

Answer: B

81. **As of January 2021, how many Olympic medals did India win in the sport of field hockey?**

A 9

B 12

C 11

D 8

Answer: C

82. **In 711 CE, Arab general _____ conquered Sind, which became a part of the Caliph's domain.**

A Qutub-ud-din Aibak

B Muhammad-Bin-Tughlaq

C Muhammad Bin Qasim

D Muhammad Ghori

Answer: C

SSC CHSL Free Mock Test

83. **On which of the following days is World Computer Literacy Day observed?**

A 5 June

B 2 December

C 13 May

D 30 September

Answer: B

84. **Which of the following recommends Minimum Support Prices for crops in India?**

A Commission for Agricultural Costs & Prices

B NITI Aayog

C Indian Council of Agricultural Research

D Fiscal Prudence Commission

Answer: A

Downloaded from cracku.in

85. **Who among the following was adjudged as the 'Player of the Series' in the Australia versus India T20I series played in December 2020?**

A Matthew Wade

B T Natarajan

C Hardik Pandya

D Mitchell Swepson

Answer: C

SSC CHSL Prevoius Papers (DOWNLOAD PDF)

86. **A message that tries to trick a person into providing information such as his social security number, bank account information or login username and password for a website is a type of malware called:**

A Worms

B Zombie

C Macro Virus

D Phishing

Answer: D

87. **What is the molecular formula for hydrochloric acid?**

A H_2SO_4

B HNO_3

C KOH

D HCl

Answer: D

88. **Mount Jopuno is situated in which of the following states?**

A Uttarakhand

B Sikkim

C Andhra Pradesh

D Himachal Pradesh

Answer: B

SSC CGL Previous Papers (DOWNLOAD PDF)

89. **From which of the following sources does the brain get energy?**

A Nucleic acids

Downloaded from cracku.in

B Fatty acids

C Amino acids

D Glucose

Answer: D

90. **Which of the following is the largest river island in India?**

A Diu island

B Gundu island

C Divar island

D Majuli island

Answer: D

91. **What is the minimum age requirement for appointment as a Governor?**

A 26 years

B 35 years

C 25 years

D 42 years

Answer: B

SSC CGL Free Mock Test (Latest Pattern)

92. **Which of the following was included as an official Olympic sport in December 2020?**

A Breakdancing

B Cricket

C Chess

D Bowling

Answer: A

93. **Who among the following was appointed as the Chairman of the National Stock Exchange (NSE) in December 2019?**

A Girish Chandra Chaturvedi

B Vikramajit Sen

C Ashok Chawla

D Ashishkumar Chauhan

Answer: A

94. **Who was the President of the Indian National Congress when India won its freedom in the year 1947?**

Downloaded from cracku.in

A Abul Kalam Azad

B Vallabhbhai Patel

C Jawaharlal Nehru

D J. B. Kripalani

Answer: D

SSC CHSL Important Questions and Answers (Download PDF)

95. **ISRO launched _____, it's 42nd communication satellite, in December 2020.**

A CMS-01

B GSAT-31

C GSAT-30

D INSAT-4CR

Answer: A

96. **As of December 2020, under the Startup India Initiative, the monthly allowance for startups with women as founder/co-founder was _____ per month for a period of one year.**

A ₹50,000

B ₹30,000

C ₹20,000

D ₹40,000

Answer: C

97. **Who among the following won the Golden Globe 2020 award for 'Best Performance by an Actor in a Motion Picture - Drama'?**

A Lucas Hedges

B Joaquin Phoenix

C John David Washington

D Jonathan Pryce

Answer: B

SSC CHSL Study Material

98. **Which of the following is NOT one of the three parallel ranges of the Himalayas in its longitudinal extent?**

A Shiwaliks

B Himshikha

Downloaded from cracku.in

C Himachal

D Himadri

Answer: B

99. **With which of the following musical instruments is the musician Pandit Shiv Kumar Sharma associated?**

A Dholak

B Sarangi

C Santoor

D Sarod

Answer: C

100. **Which of the following festivals is called the month of merits and is celebrated between May and June?**

A Saga Dawa

B Bhanu Jaati

C Losar

D Losoong

Answer: A

SSC CHSL Free App

SSC CHSL Free Mock Test

SSC CHSL Prevoius Papers (DOWNLOAD PDF)

SSC CGL Previous Papers (DOWNLOAD PDF)

SSC CGL Free Mock Test (Latest Pattern)

SSC CHSL Important Questions and Answers (Download PDF)

SSC CHSL Study Material

SSC CHSL Free App

Daily Free SSC Practice Set

Free SSC Study Material (18,000 Solved Questions)

Downloaded from cracku.in

1500+ Very Important Free SSC Solved Questions

SSC Exam Update Videos & Free Study Material (YouTube Channel)

Latest Job Updates on Telegram - Join here

Join SSC Daily Quiz Telegram Group

Downloaded from cracku.in